**1.** Определите, на каком из рисунков изображен график функции $y = \log_a x$ при $a > 1$.

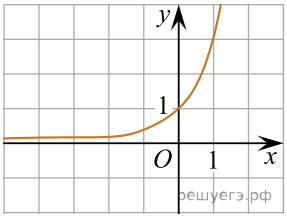


Рис. а)

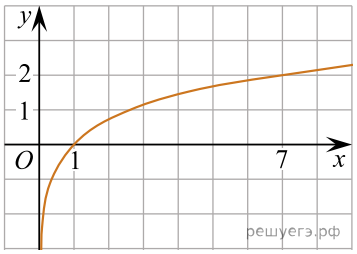


Рис. б)

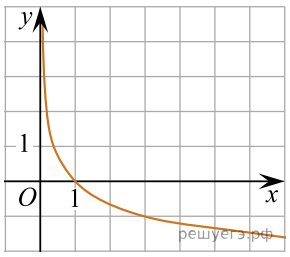


Рис. в)

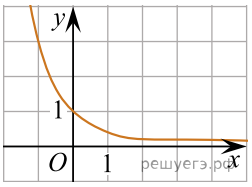


Рис. г)